cuemath
THE MATH EXPERT

Get better at Math. Get better at everything.

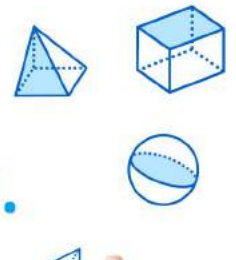

Come experience the Cuemath methodology and ensure your child stays ahead at math this summer.

Adaptive Platform | **Interactive Visual Simulations** | **Personalized Attention**

For Grades 1 - 10

LIVE online classes by trained and certified experts.

Get the Cuemath advantage

Book a FREE trial class

3rd Grade Angles Worksheets

1) When two rays intersect at a point it forms an _____ between the rays.

2) Name the angles marked in each of the following diagrams.

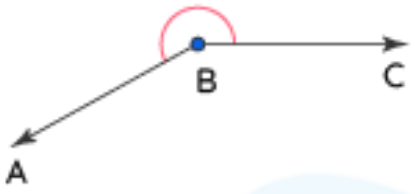

Figure 1

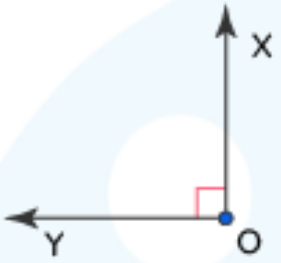

Figure 2

3) An angle whose measure is less than that of a right angle is _____.

4) Which angle is smaller?

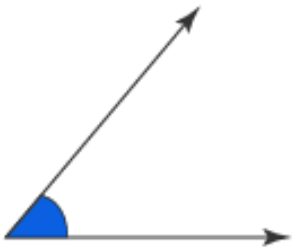

Angle:

a)

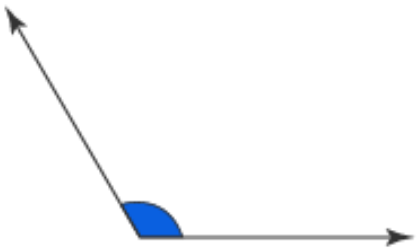

Angle:

b)

5) Which of the following are angles?

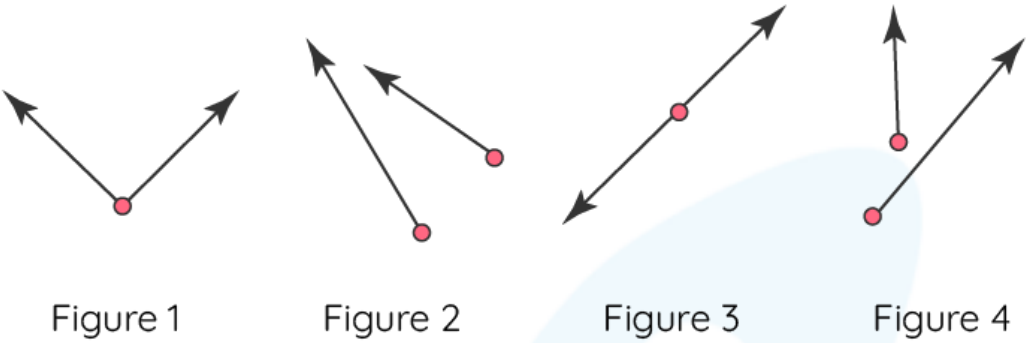

Figure 1 Figure 2 Figure 3 Figure 4

6) An angle of measure 180° is called a _____

7) Which of the following are not angles?

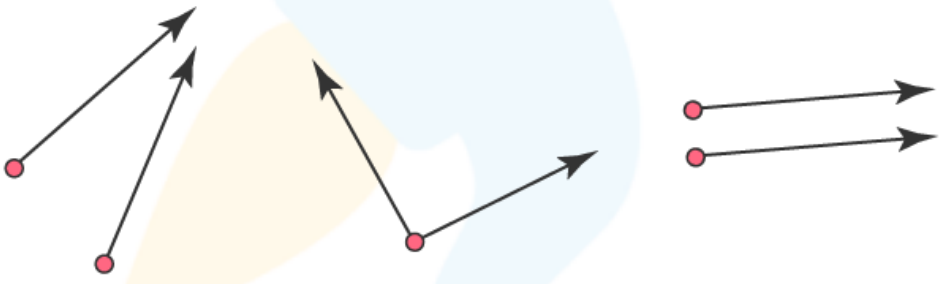

Figure 1 Figure 2 Figure 3

8) Arrange the following angles in ascending order.

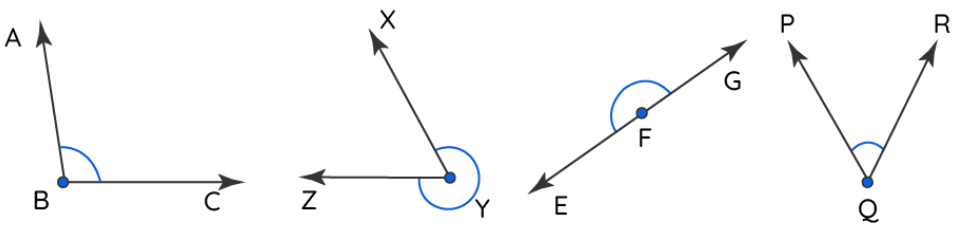

Figure 1 Figure 2 Figure 3 Figure 4

9) By observation, arrange the following angles in descending order.

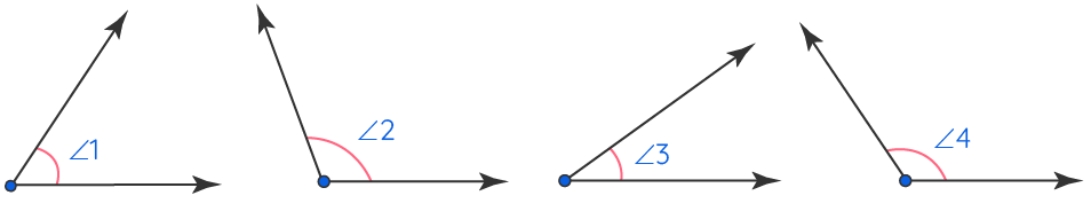

Figure 1 Figure 2 Figure 3 Figure 4

10) Draw and label an angle using the given information.

a) An obtuse angle ∠ABC

b) A right angle ∠XYZ

cuemath
THE MATH EXPERT

When you learn math in an interesting way, you never forget.

25 Million
Math classes & counting

100K+
Students learning Math the right way

20+ Countries
Present across USA, UK, Singapore, India, UAE & more.

Why choose Cuemath?

"Cuemath is a valuable addition to our family. We love solving puzzle cards. My daughter is now visualizing maths and solving problems effectively!"

- Gary Schwartz

"Cuemath is great because my son has a one-on-one interaction with the teacher. The instructor has developed his confidence and I can see progress in his work. One-on-one interaction is perfect and a great bonus."

- Kirk Riley

"I appreciate the effort that miss Nitya puts in to help my daughter understand the best methods and to explain why she got a problem incorrect. She is extremely patient and generous with Miranda."

- Barbara Cabrera

Get the Cuemath advantage

Book a FREE trial class

cuemath
THE MATH EXPERT

ANSWERS

1. angle	6. Straight angle
2. ∠ABC, ∠XOY	7. Figure 1 and Figure 3
3. Acute	8. Figure 4 < Figure 1 < Figure 3 < Figure 2
4. a)	9. Figure 4 > Figure 2 > Figure 1 > Figure 3
5. Figure 1 and Figure 3	10. 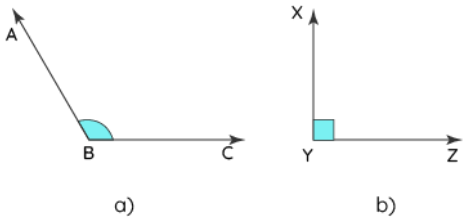

FUN FACT

1. Did you know walking on a straight road forms a 180° angle?
2. The sum of angles of a triangle is equal to 180°
3. The letter 'L' forms a 90° between it's standing and sleeping line.